Student Name_____

Alaska Department Of Education & Early Development
Assessment & Accountability Unit

Practice Test

Alternate Assessment - SCIENCE
STUDENT MATERIALS

TASK 1.4: CONCEPTS OF PHYSICAL SCIENCE

Item 1: Is a fire cold, hot, or soft?



fire

cold	hot	soft

Item 2: Which one is made of paper?



basketball



saw



book

Item 3: Which one shows how to turn on a light bulb?



telephone

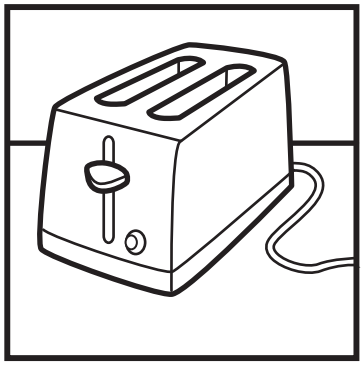

toaster



switch

TASK 1.4: CONCEPTS OF PHYSICAL SCIENCE

Item 4: Which picture shows a liquid?



milk



banana



pizza

Item 5: Which picture shows ice?

can



ice cubes



juice box

Item 6: Which picture shows a book dropping to the floor?



1



2



3

TASK 2.4: CONCEPTS OF LIFE SCIENCE

Item 1: Which picture shows the parent of a bunny?


fox


cat


rabbit

Item 2: Which one develops from parents?


fish


cake


ice cream cone

Item 3: Which animal lives in water?


rabbit


bear


whale

TASK 2.4: CONCEPTS OF LIFE SCIENCE

Item 4: Which animal can climb a tree?



cow



monkey



zebra

Item 5: Which picture shows a living thing?



basketball



plant



pencil

Item 6: Which one is non-living?



cow



monkey



pencil

TASK 3.4: CONCEPTS OF EARTH SCIENCE

Item 1: Which picture shows soil/dirt?



1

2

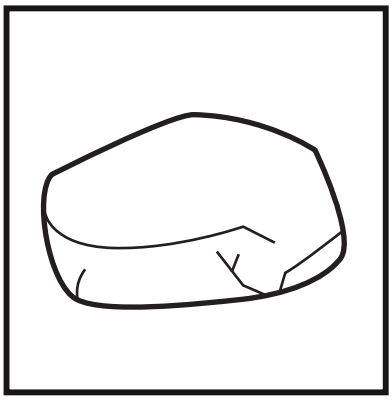

3

Item 2: Which picture shows when the weather is wet?

1



2



3

Item 3: Which picture shows when it is likely to be hot?



cloudy



sunny



snowy

TASK 3.4: CONCEPTS OF EARTH SCIENCE

Item 4: Which picture shows a river?

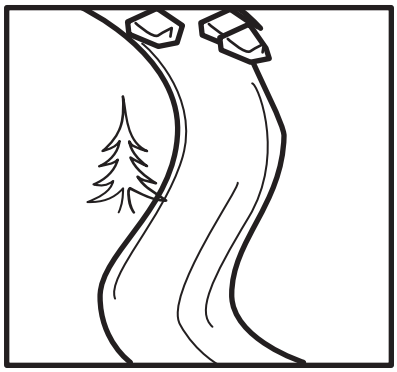

1

2



3

Item 5: Which picture shows a forest?

1

2



3

Item 6: Which one are you most likely to see when it is daylight?



Sun

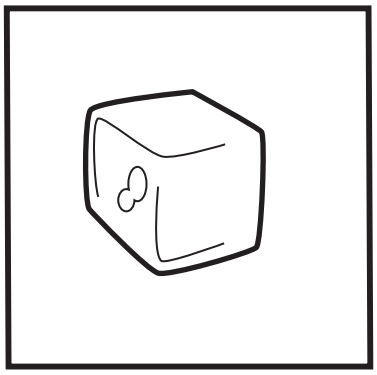

ice cube

Moon

TASK 4.4: HISTORY AND NATURE OF SCIENCE, SCIENCE AND TECHNOLOGY

Item 1: What happens if the bowl of water gets tipped on its side?

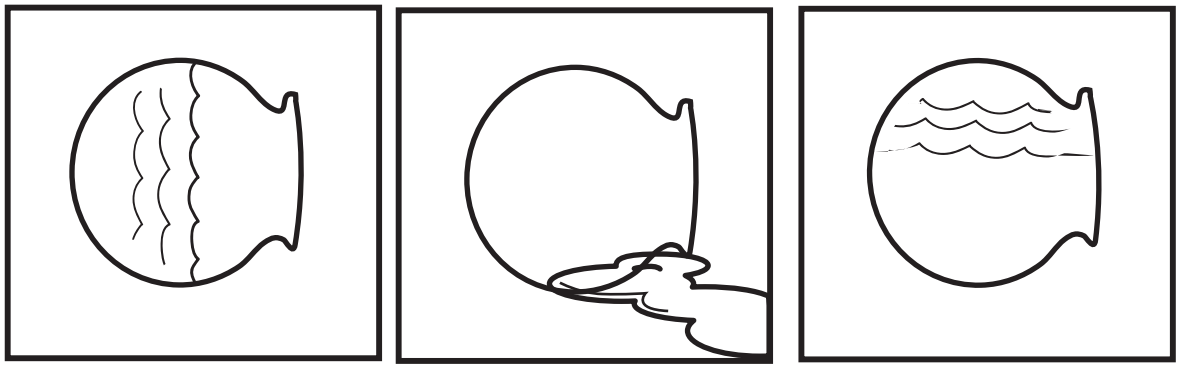

water stays the same | water spills out | water goes to the top

Item 2: What happens when a metal spoon is dropped in a bowl with water?



floats in the middle | floats on top | sinks to the bottom

Item 3: Which way will the apple go when it is dropped?



The apple falls to the ground. | The apple floats up into the air. | The apple moves to the side.

TASK 4.4: HISTORY AND NATURE OF SCIENCE, SCIENCE AND TECHNOLOGY

Item 4: Which one is grass?



1 2 3

Item 5: Which one does wood come from for making a pencil?



flower paper tree

Item 6: Which one would you use to write on a piece of paper?



pencil key microscope

TASK 4.8: SCIENCE AND TECHNOLOGY

Item 1: What would someone wear to protect their eyes from the sun?


shirt


pants


cap

Item 2: Which tool would you use to write on a piece of paper?

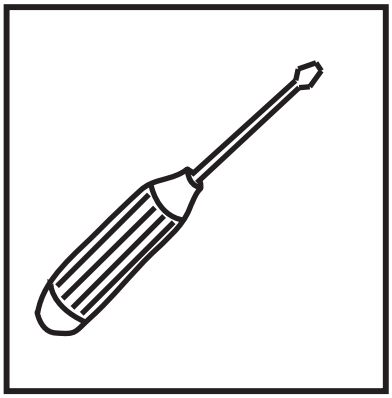
screw driver


pencil

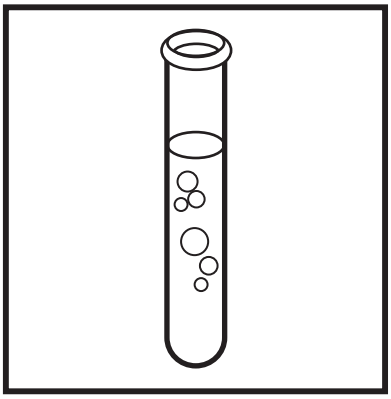
test tube

Item 3: Which tool would best attract a piece of metal?


saw

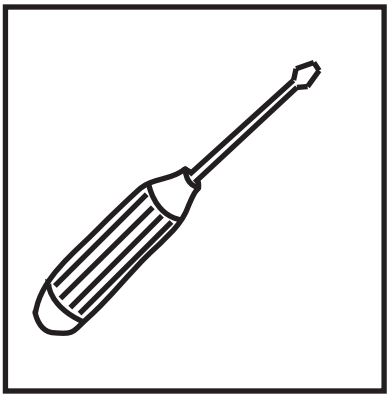
screw driver

magnet

TASK 4.8: SCIENCE AND TECHNOLOGY

Item 4: Which of these would you use to bring food to your mouth?

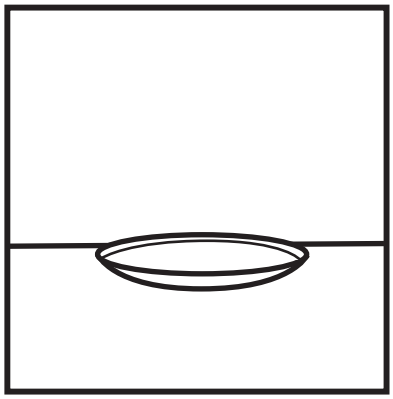

plate



fork



bowl

Item 5: Which tool would you use to pull nails out of a board?



hammer



saw



wrench

Item 6: Which picture shows something you can cook food on?



washing machine

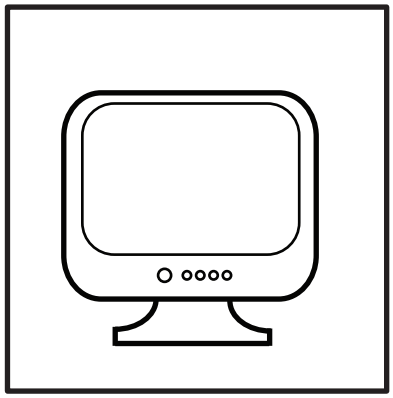

television



stove

TASK 1.10: CONCEPTS OF PHYSICAL SCIENCE

Item 1: Which picture shows something that goes into making ice cream?



pizza

milk

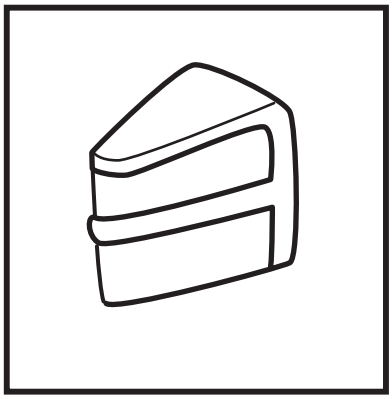

cake

Item 2: Which <u>two</u> pictures show what goes into making a pizza?



pepperoni

flour



ice cube

TASK 1.10: CONCEPTS OF PHYSICAL SCIENCE

Item 3: Which one runs on electricity?



light bulb



plant



person

Item 4: Which picture shows what we would plug a microwave into?

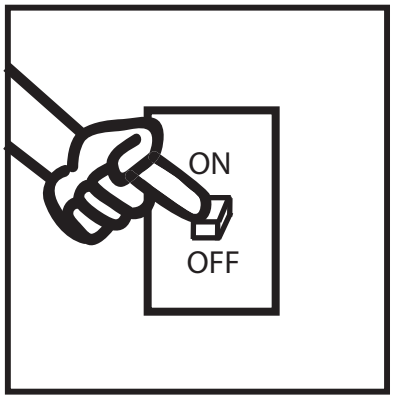

switch



gas can



electrical outlet

TASK 1.10: CONCEPTS OF PHYSICAL SCIENCE

Item 5: Which picture shows something that is a solid?



cloud



water



pencil

Item 6: Which picture shows something that is a liquid?



ice cubes



water



a boat

TASK 1.10: CONCEPTS OF PHYSICAL SCIENCE

Item 7: Which picture shows the fastest way the ball could be rolled?

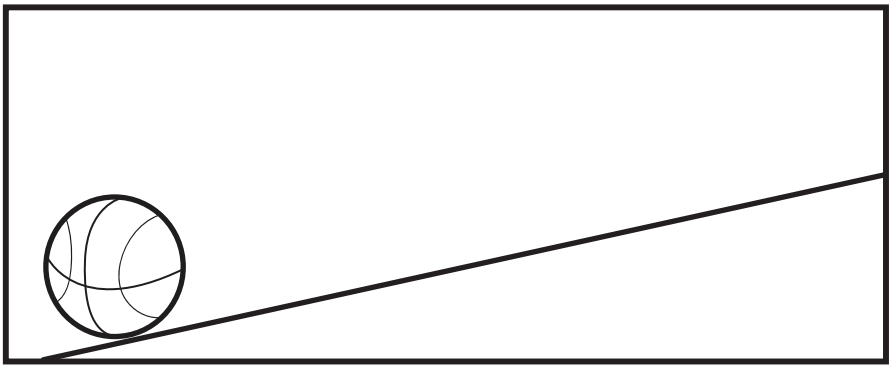

up a hill



flat ground

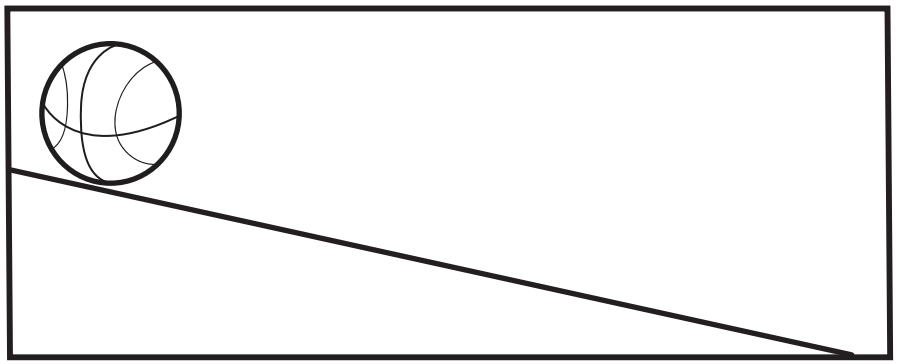

down a hill

TASK 1.10: CONCEPTS OF PHYSICAL SCIENCE

Item 8: When the ice cream cone melts, which way do the drops of ice cream melt, up, down, or sideways?

ice cream cone melting

up	down	sideways

TASK 2.10: CONCEPTS OF LIFE SCIENCE

Item 1: Which puppy inherited the spots?



puppy #1



puppy #2



puppy #3

TASK 2.10: CONCEPTS OF LIFE SCIENCE

Item 2: Which animal is the puppy's parent?





cat



dog



cow

Item 3: Which animal has adapted a tail to help it climb trees?



lion



monkey



zebra

TASK 2.10: CONCEPTS OF LIFE SCIENCE

Item 4: Which animal has adapted wings to fly?



dog



bird



tiger

Item 5: Which animal is an omnivore, or an animal that eats both plants and animals?



horse



bear



zebra

TASK 2.10: CONCEPTS OF LIFE SCIENCE

Item 6: Which animal is an herbivore, or an animal that only eats plants?



horse



bear



lion

TASK 3.10: CONCEPTS OF EARTH SCIENCE

Item 1: Which picture shows where big rocks are made from?



forests



mountains

flowers

Item 2: Which picture shows rocks that are the least weathered?

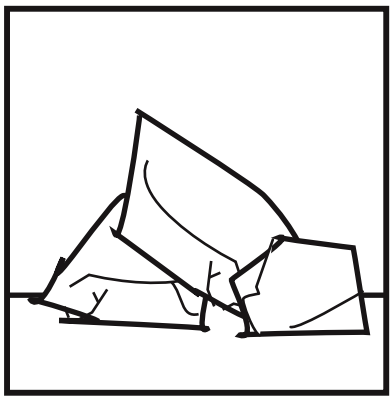

1



2

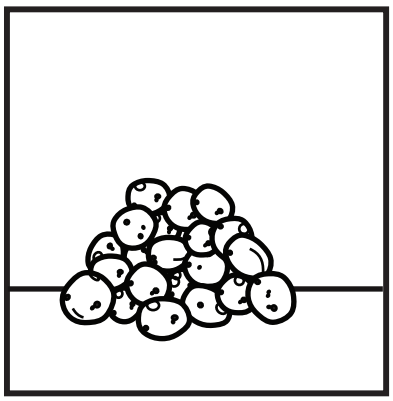

3

TASK 3.10: CONCEPTS OF EARTH SCIENCE

Item 3: Which picture shows when the weather is wet?



sunny

rainy



cloudy

Item 4: Which picture shows water in a state of gas?



cloudy

rainy



snowy

TASK 3.10: CONCEPTS OF EARTH SCIENCE

Item 5: Which picture best shows water that will cause change to the land?



lake

river

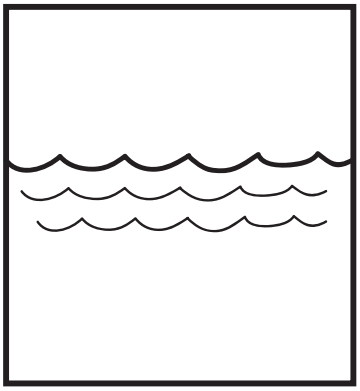

water

Item 6: Which one orbits around the earth?



Sun



Moon



Saturn

Item 7: In the winter, which one shines brightest during the night?



Moon



Sun



Saturn

TASK 3.10: CONCEPTS OF EARTH SCIENCE

Item 8: Which one is a star?



Moon



Sun



Saturn